Modified Enlarged 18pt

OXFORD CAMBRIDGE AND RSA EXAMINATIONS

Tuesday 17 June 2025 – Afternoon

Level 3 Free Standing Mathematics Qualification: Additional Mathematics

6993/01 Paper 1

Time allowed: 2 hours
plus your additional time allowance

YOU MUST HAVE:
the Formulae Sheet for Level 3 Free Standing Mathematics Qualification: Additional Mathematics (with this document)

YOU CAN USE:
a scientific or graphical calculator

Please write clearly in black ink.

Centre number | | | | | |

Candidate number | | | | |

First name(s) _____

Last name _____

READ INSTRUCTIONS OVERLEAF

© OCR 2025 [100/2548/0]
DC (DE/TC) 364120

27420963 43

INSTRUCTIONS

Use black ink. You can use an HB pencil, but only for graphs and diagrams.

Write your answer to each question in the space provided. If you need extra space use the lined pages at the end of this booklet. The question numbers must be clearly shown.

Answer ALL the questions.

Where appropriate, your answer should be supported with working. Marks might be given for using a correct method, even if your answer is wrong.

Give your final answers to a degree of accuracy that is appropriate to the context.

INFORMATION

The total mark for this paper is 100.

The marks for each question are shown in brackets [ ].

ADVICE

Read each question carefully before you start your answer.

FORMULAE

FSMQ Additional Mathematics (6993)

Binomial series

$(a+b)^n = a^n + {}^nC_1 a^{n-1}b + {}^nC_2 a^{n-2}b^2 + \ldots + {}^nC_r a^{n-r}b^r + \ldots + b^n$, for positive integers, n,

where ${}^nC_r = {}_nC_r = \binom{n}{r} = \frac{n!}{r!(n-r)!}$, $r \leqslant n$

The binomial distribution

If $X \sim B(n, p)$ then $P(X = x) = \binom{n}{x} p^x (1-p)^{n-x}$

Numerical methods

Trapezium rule:

$\int_a^b y \, \mathrm{d}x \approx \frac{1}{2}h\{(y_0 + y_n) + 2(y_1 + y_2 + \ldots + y_{n-1})\}$,

where $h = \frac{b-a}{n}$

Kinematics

Variable acceleration formulae

$v = \frac{\mathrm{d}s}{\mathrm{d}t}$

$a = \frac{\mathrm{d}v}{\mathrm{d}t} = \frac{\mathrm{d}^2 s}{\mathrm{d}t^2}$

$s = \int v \, \mathrm{d}t$ and $v = \int a \, \mathrm{d}t$

Constant acceleration formulae

$v = u + at$

$s = ut + \frac{1}{2}at^2$

$s = \frac{1}{2}(u+v)t$

$v^2 = u^2 + 2as$

$s = vt - \frac{1}{2}at^2$

1 Find the coefficient of x^3 in the expansion of $(2 - 3x)^5$. [3]

1

2 **In this question you must show detailed reasoning.**

Solve the inequality $7 < 3(x-2)+1 < 16$. [3]

2

3 Determine the exact value of $x^2 - x + 5$ when $x = 3 + \sqrt{2}$. [3]

3

4 Determine the equation of the tangent to the curve $y = 4 + x + x^2$ at the point (1, 6). [4]

4

5 (a) On the grid opposite, indicate the region for which the following inequalities hold.
You should shade the region that is NOT satisfied by the inequalities. [4]

$2x + 3y \leqslant 12$

$x + 3y \geqslant 9$

$x \geqslant 0$

(b) Write down the minimum value of $2x + y$ within this region. [1]

5 (b) _____

_____

_____

_____

_____

_____

5 (a)

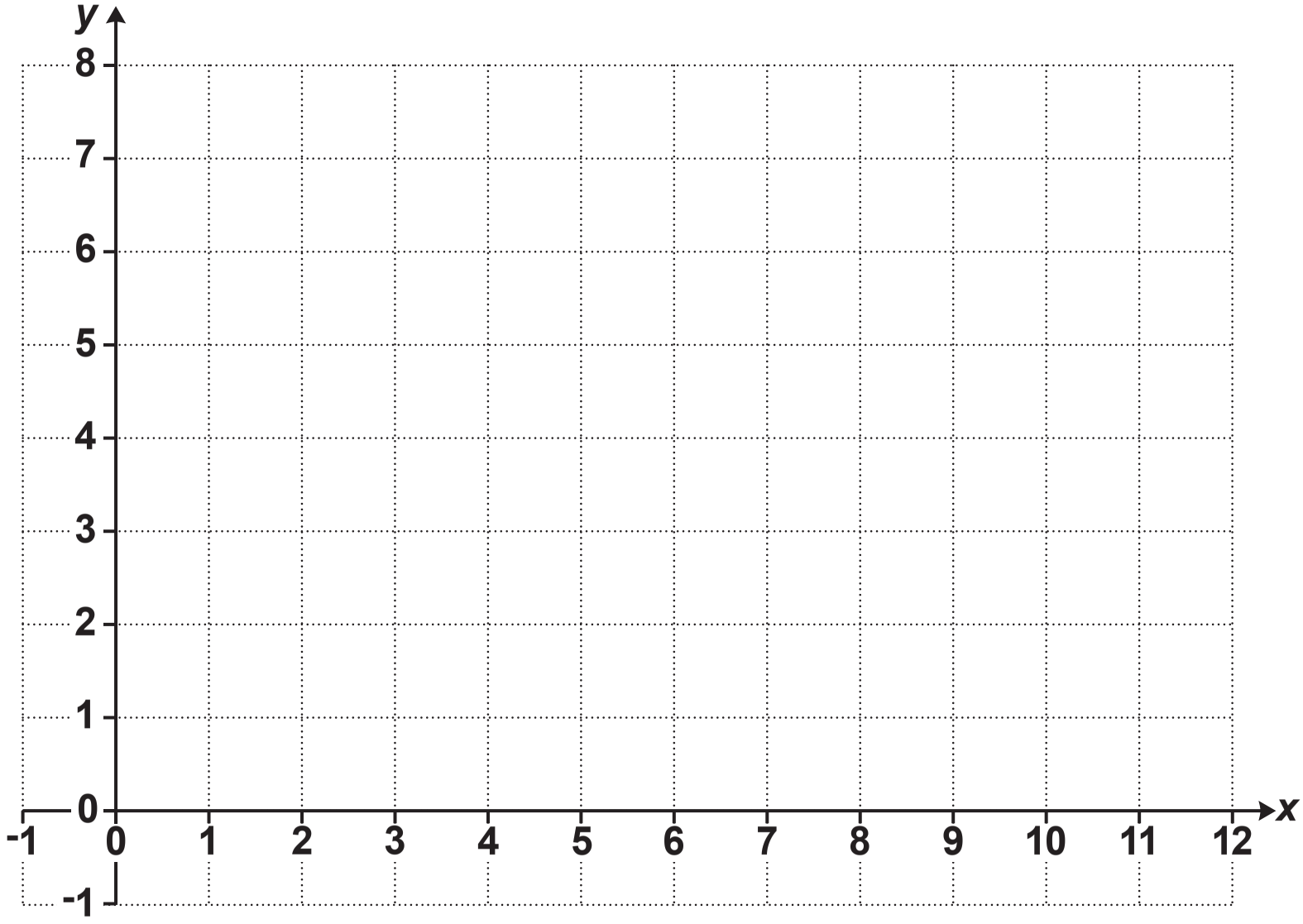

There is a spare copy of this grid on page 36. If you wish to offer a second attempt then you must cross through the attempt on this grid that you wish to discard.

6 A car accelerates from rest in a straight line. At time t seconds the displacement of the car, s metres, is modelled by the equation

$$s = \frac{t^3}{2} - \frac{t^4}{24}.$$

(a) Determine the maximum velocity of the car. [6]

(b) Describe what is happening when $t \geqslant 9$. [2]

6 (a)

6 (b)

7 A small club consists of 10 members.

(a) In how many ways can 4 members be chosen from the 10 members? [2]

(b) You are given that half of the members are male and half are female.

In how many ways can 4 members be chosen so that

(i) they are either all male or all female, [2]

(ii) 2 are male and 2 are female? [2]

7 (a) _____

_____

_____

_____

_____

_____

7 (b) (i)

7 (b) (ii)

8 In this question you must show detailed reasoning.

(a) Solve the simultaneous equations $y = 2x^2 - 5x + 4$ and $x + y = 2$. [4]

(b) State the geometrical relationship between the graphs of $y = 2x^2 - 5x + 4$ and $x + y = 2$. [1]

8 (a)

8 (b)

9 Tom plans to travel by car from a point A to a point B. There are two routes that he can take. He can take either a motorway route or a non-motorway route. Tom models the roads used on these two routes as straight lines. The line AB represents the non-motorway route. The lines AC and CB represent the two motorways used for the motorway route.

The diagram illustrates the two routes where C is the junction of the motorways.

Not to scale

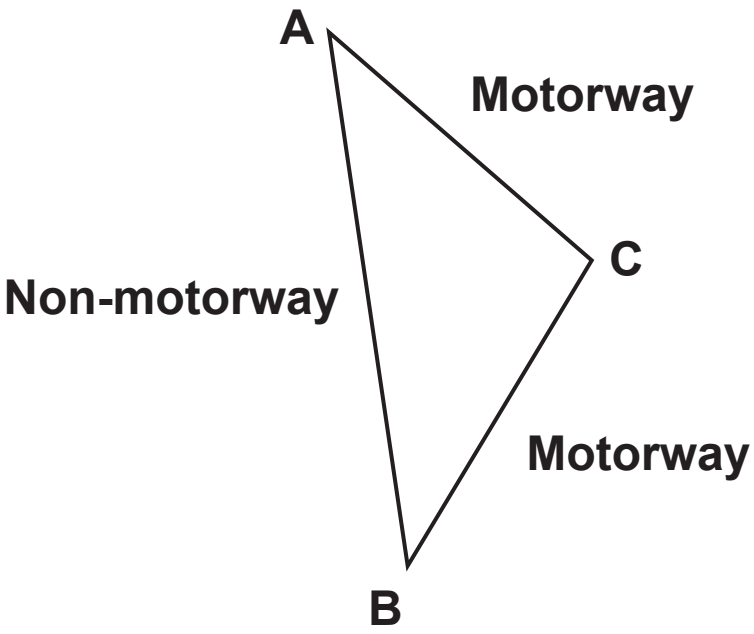

You are given that AC = 50 km, CB = 40 km and angle ACB = 120°.

(a) Calculate the distance AB. [3]

9 (a)

In his model Tom assumes that:
he drives at a constant speed
he can move through the junction at C without losing speed
his speed on the non-motorway route is kv where v is his speed on the motorway route, k is a constant and $k < 1$.

(b) Determine the value of k such that the time taken to travel each route is the same. [3]

9 (b)

10 In this question you must show detailed reasoning.

Solve the equation $\frac{1}{x-5} - \frac{1}{x} + \frac{5}{6} = 0$. [5]

10

11 A rectangular metal plate OACD is aligned on a coordinate system such that O is the origin and A, C and D have coordinates (0, 16), (6, 16) and (6, 0) respectively.
A curved section ABC is removed from OACD to leave the shape OABCD shown in the diagram. The curved edge ABC has equation $y = x^2 - 6x + 16$ and B is the stationary point on the curve.

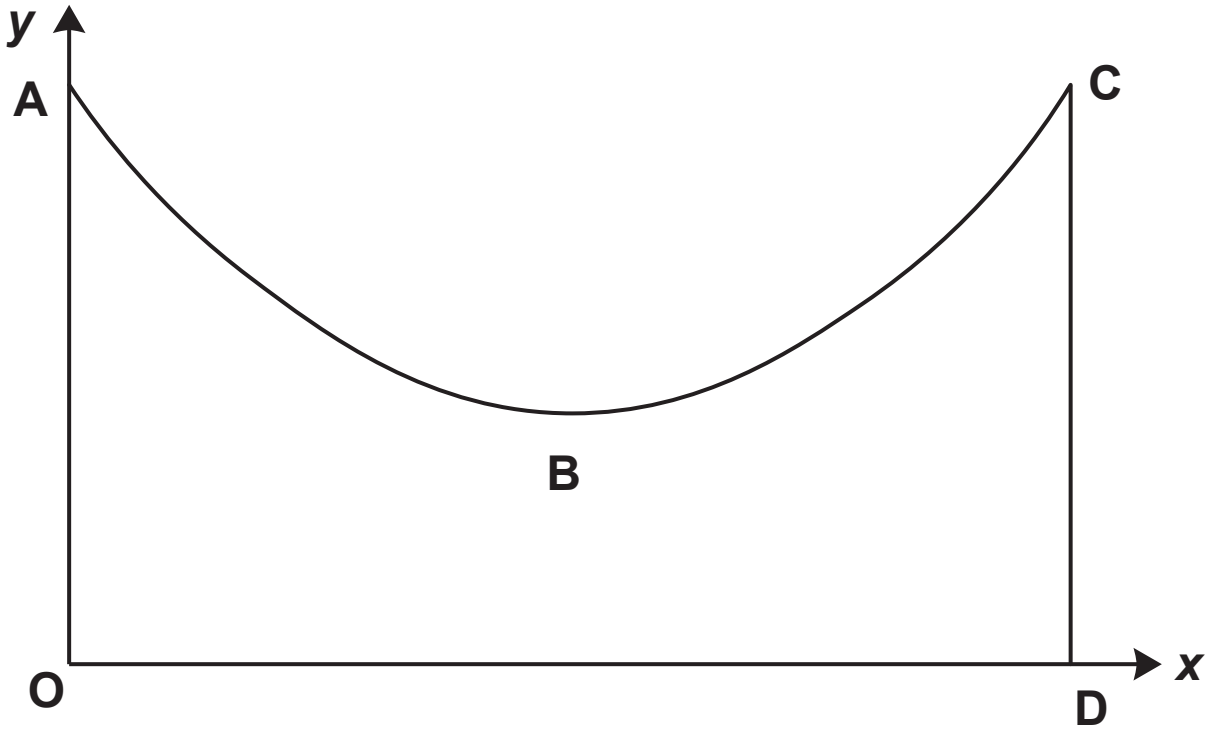

(a) By completing the square, determine the coordinates of B. [3]

(b) The line $y = k$ is such that it cuts the AREA of the shape OABCD in half.

Find the value of k. [5]

11 (a)

11 (b)

12 Heidi and Charlie have been asked to solve the equation $f(x) = 1.3^x - x = 0$.

(a) Show by sign change that $f(x) = 0$ has a root, α, in the interval [1,2]. [2]

(b) Heidi attempts to solve the equation $f(x) = 0$ using the iterative formula $x_{r+1} = \dfrac{\log_{10} x_r}{\log_{10} 1.3}$.

She starts with $x_0 = 1.4$. Show that the sequence derived from this iterative formula fails to find α. [2]

(c) Charlie attempts to solve the equation $f(x) = 0$ using the iterative formula $x_{r+1} = 1.3^{x_r}$.
Starting with $x_0 = 1.4$, determine the value of α correct to 3 significant figures. [3]

12 (a) _____

_____

_____

_____

12 (b)

12 (c)

(d) (i) Plot both the curve $y = 1.3^x$ and the line $y = x$ on the grid opposite to show that there is another root, β, which you should identify on your graph. [4]

(ii) Give the integer interval within which β lies. [1]

(e) Without doing any further calculation, use your graph to explain why Charlie will not find β using his iterative formula. [2]

12 (d) (ii) _____

_____

12 (e) _____

_____

_____

12 (d) (i)

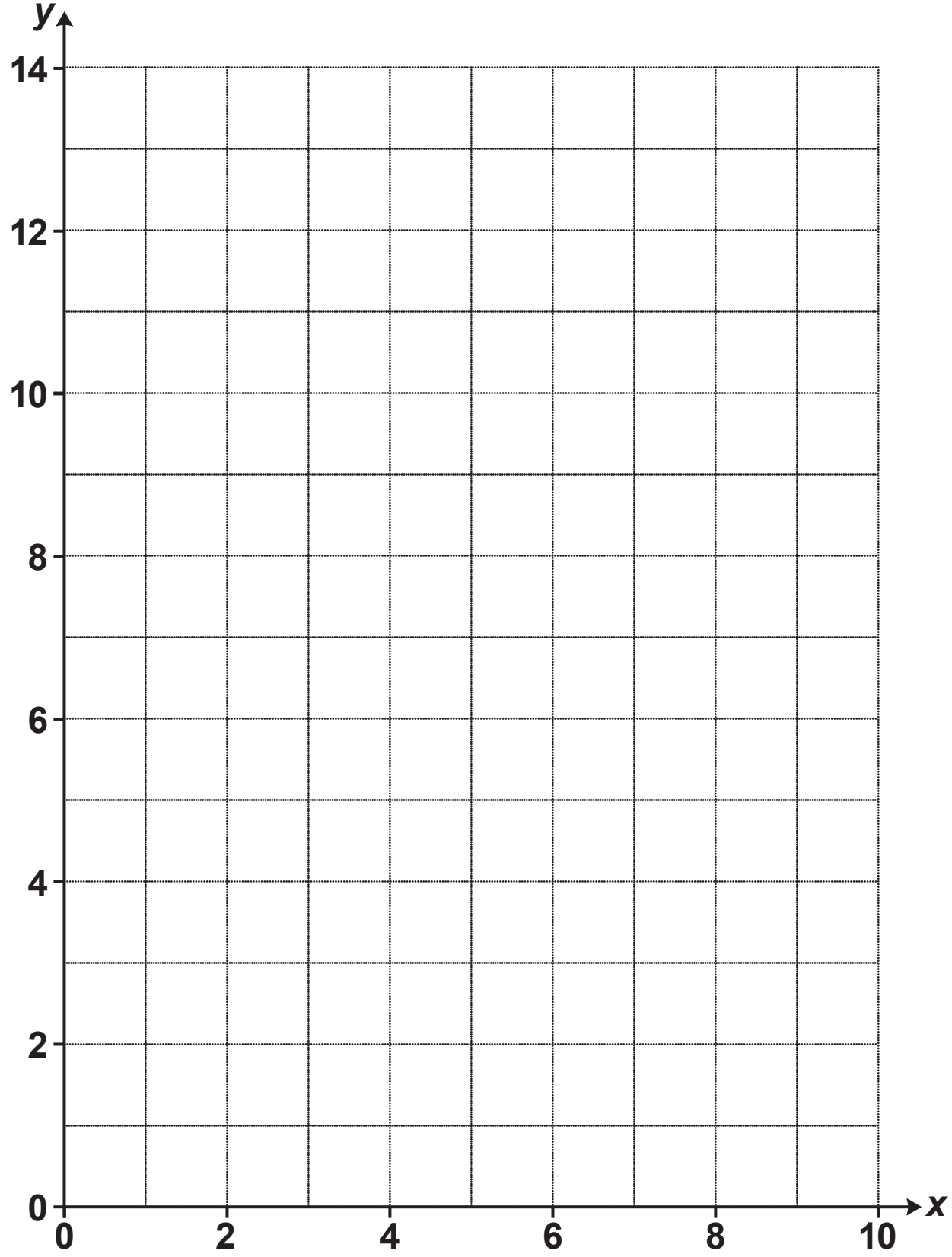

There is a spare copy of this grid on page 37. If you wish to offer a second attempt then you must cross through the attempt on this grid that you wish to discard.

13 (a) You are given that $\sin 2\theta = 0.7$.

Find the values of θ for $0° \leqslant \theta \leqslant 360°$.
Give your answers correct to 1 decimal place. [3]

(b) Given that $0° < \theta < 90°$, show that
$$\frac{1}{\sin^2\theta} - \frac{1}{\tan^2\theta} \equiv 1.$$ **[3]**

13 (a)

13 (b)

14 **A tower AB stands vertically at a point A. C is a point due south of A and on the same horizontal level. The distance AC is 55 m. From C the angle of elevation of B is 36°.**

D is a point due west of the tower and 15 m higher than A and C. The horizontal distance of D from the tower is 35 m.

Find the angle of elevation of B from D. [5]

14

15 The table shows population data for a country. t is the number of years after 1920.

Years after 1920 (t)	0	20	40	60	80	100
Population in millions (p)	20	31.7	51.3	79.6	126.2	200

Jane believes that this population growth may be modelled by the equation $p = c \times 10^{kt}$ where c and k are constants.

(a) Derive an equation for $\log_{10} p$ in terms of c, k and t. [3]

(b) Plot the points (t, $\log_{10} p$) for the 6 values of t on the grid opposite.
(You may use the blank row in the table above for your values of $\log_{10} p$.) [3]

(c) On the grid draw a line of best fit. [1]

15 (a) _____

_____

_____

_____

_____

15 (b)

15 (c)

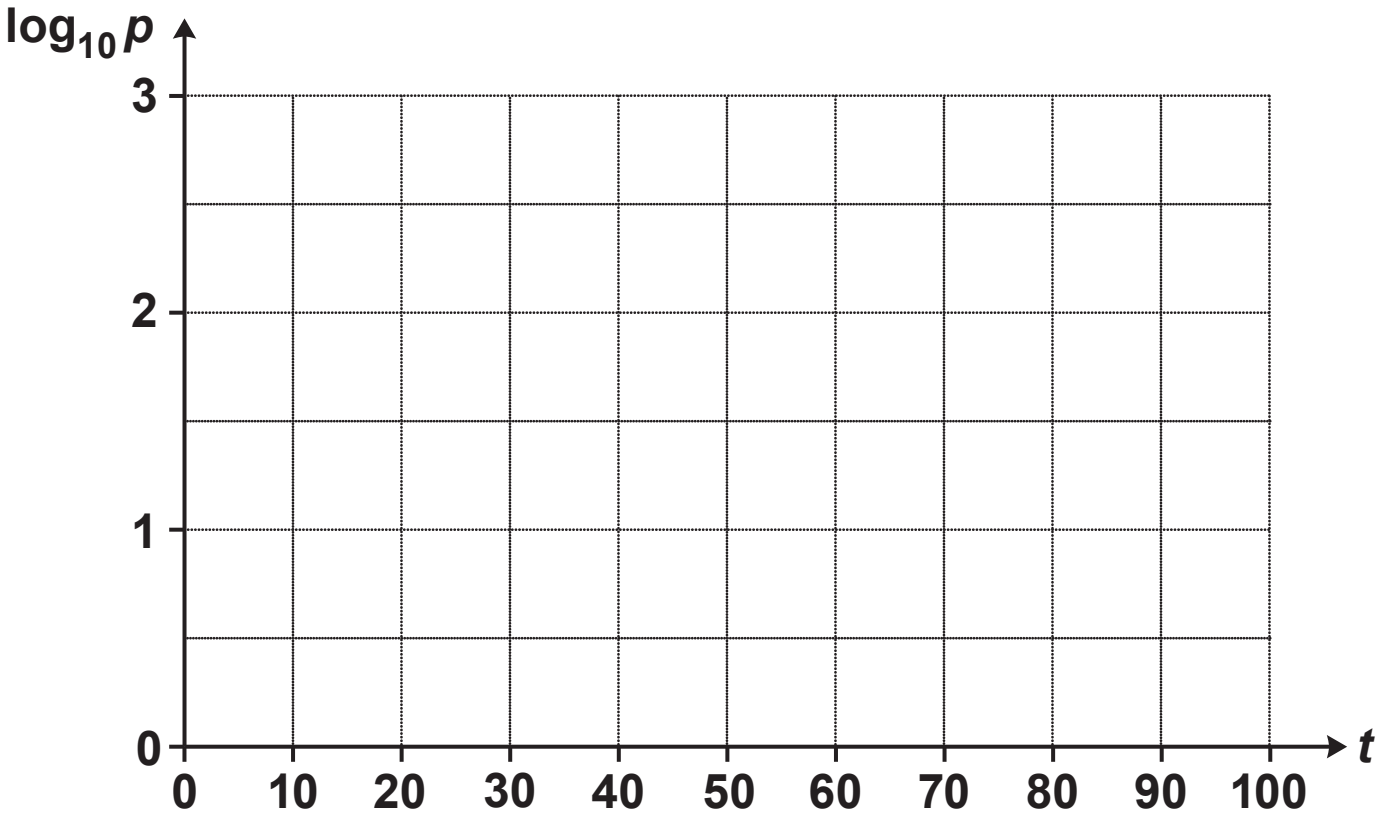

There is a spare copy of this grid on page 38. If you wish to offer a second attempt then you must cross through the attempt on this grid that you wish to discard.

(d) (i) State the value of *c*. [1]

(ii) Using your line, or otherwise, estimate a value for *k*. [1]

(e) According to the model what will be the population in 2040? [2]

(f) Give a reason why this model may NOT be realistic in the long term. [1]

15 (d) (i) _____

_____

_____

_____

_____

_____

15 (d) (ii) _____

_____

_____

_____

_____

_____

15 (e) _____

_____

_____

_____

15 (f) _____

_____

_____

_____

16 A square with vertices ABCD is aligned in a coordinate system where the coordinates of A, B, C and D are (−8, 0), (−8, 16), (8, 16) and (8, 0) respectively.
The origin, O, is the midpoint of AD.

A circle is such that it passes through the points B and C and touches the line AD at the origin as shown in the diagram.

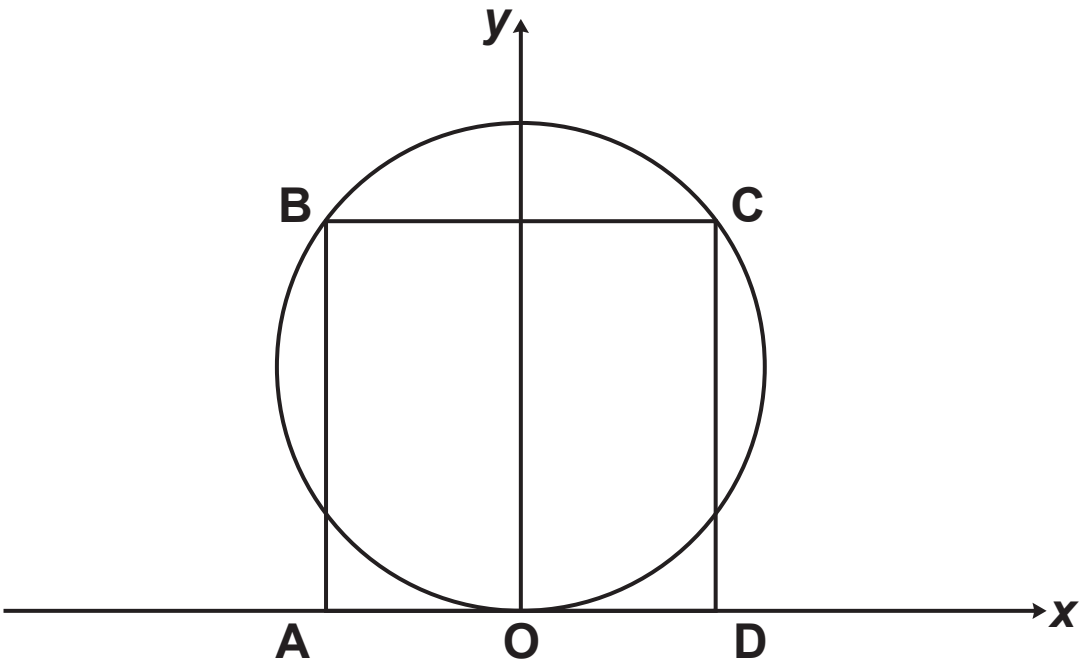

Find

(a) the radius of the circle, [4]

(b) the equation of the circle. [3]

16 (a) _____

_____

_____

_____

_____

16 (b) _____

_____

_____

END OF QUESTION PAPER

5 (a) **This is a spare copy of the grid for question 5(a). Only write on this page if you want to offer a second attempt at the graph.**
If you do so, then you must cross through the first attempt on page 9.

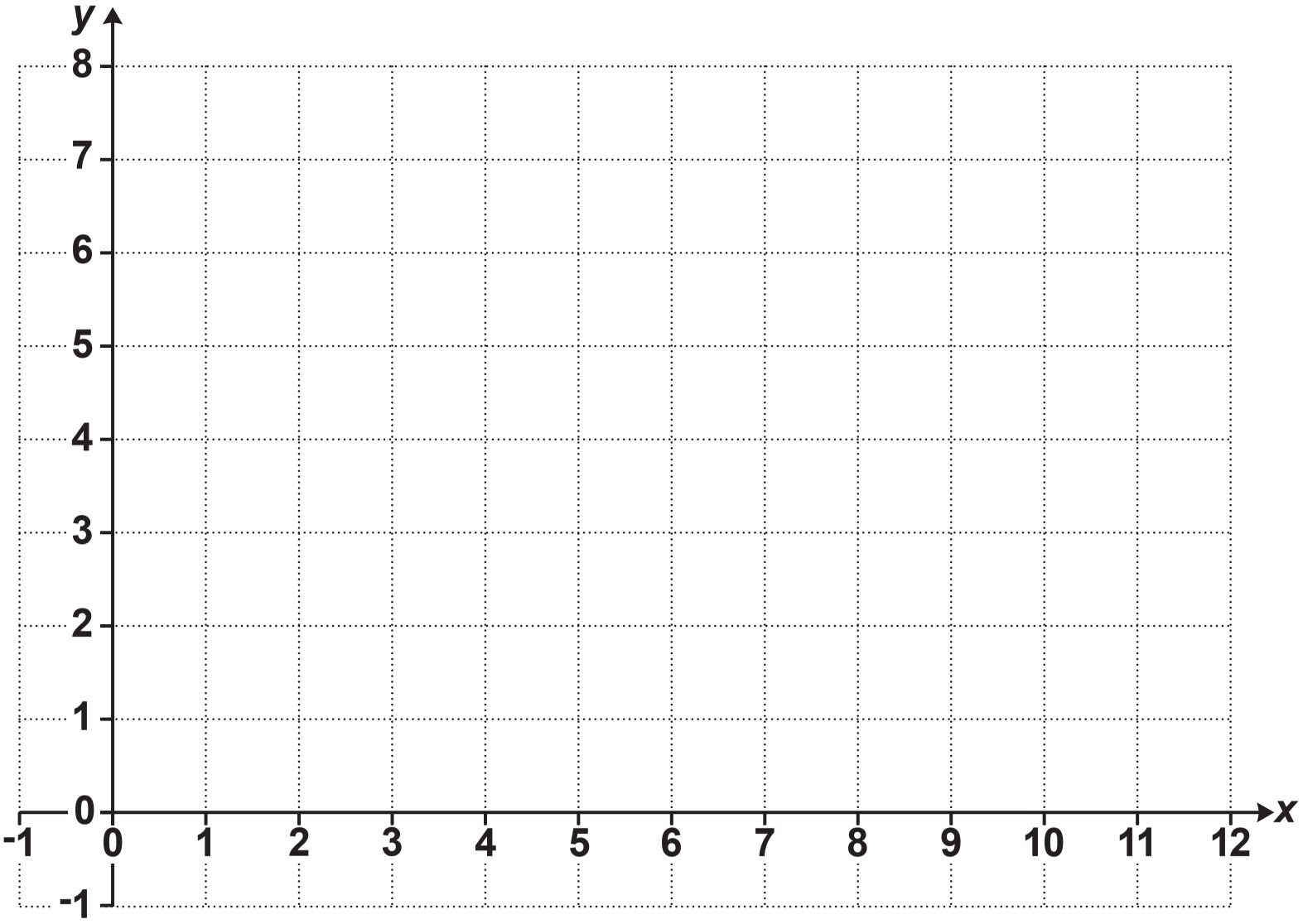

12 (d) (i) This is a spare copy of the grid for question 12(d)(i). Only write on this page if you want to offer a second attempt at the graph.
If you do so, then you must cross through the first attempt on page 25.

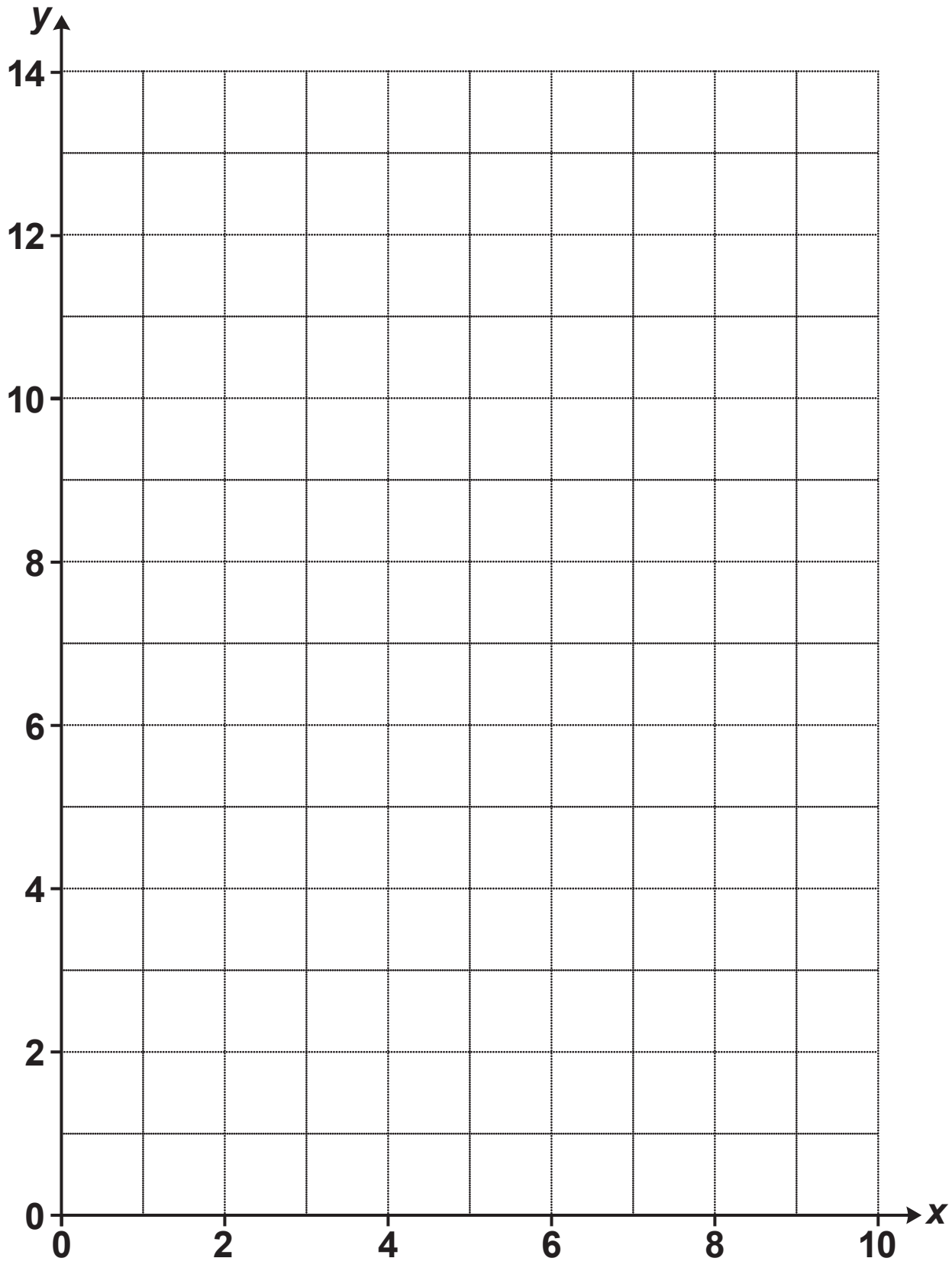

15 (b) This is a spare copy of the grid for question 15(b)and 15(c). Only write on this
15 (c) page if you want to offer a second attempt at the graph.
If you do so, then you must cross through the first attempt on page 31.

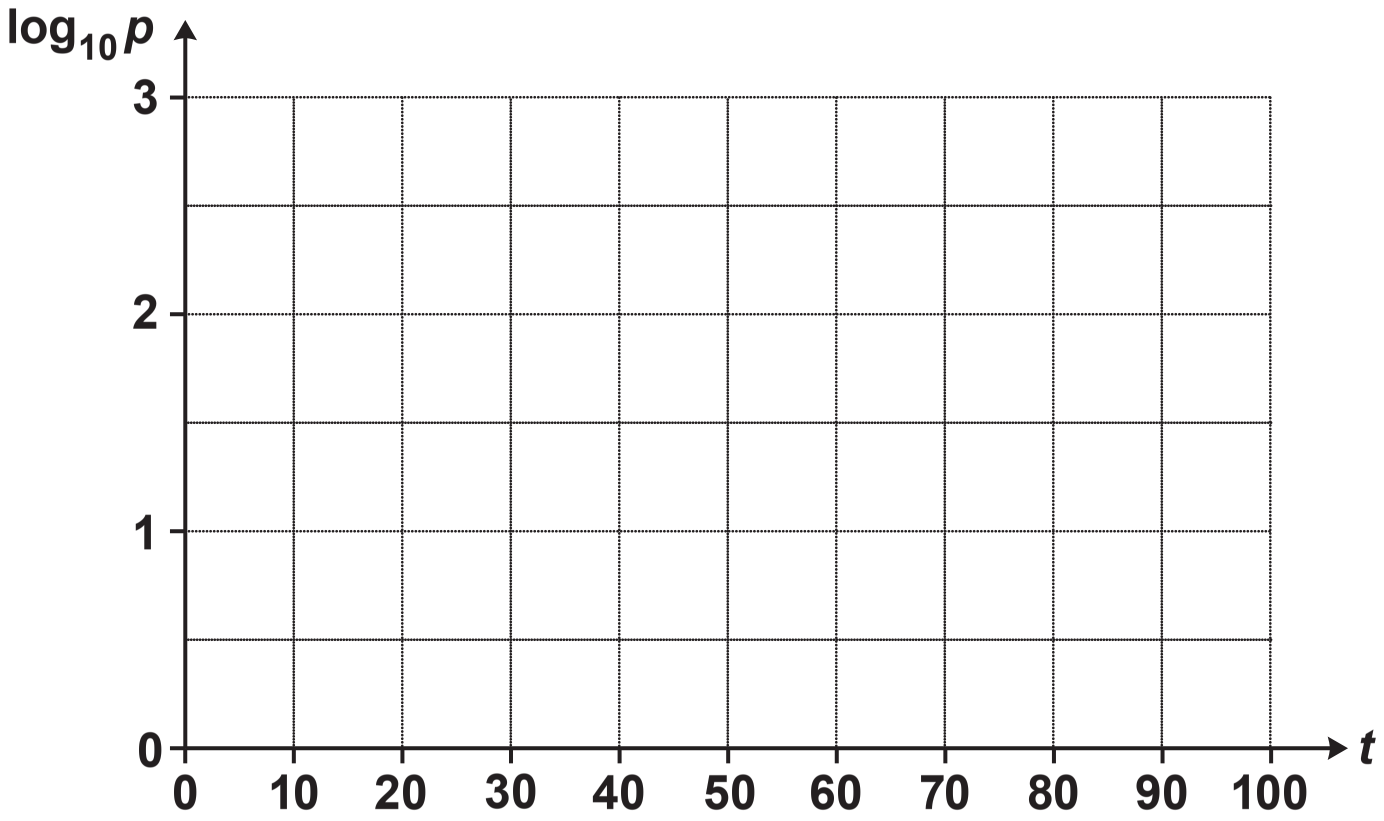

EXTRA ANSWER SPACE

If you need extra space use these lined pages. You must write the question numbers clearly in the margin.

OCR
Oxford Cambridge and RSA

Copyright Information

OCR is committed to seeking permission to reproduce all third-party content that it uses in its assessment materials. OCR has attempted to identify and contact all copyright holders whose work is used in this paper. To avoid the issue of disclosure of answer-related information to candidates, all copyright acknowledgements are reproduced in the OCR Copyright Acknowledgements Booklet. This is produced for each series of examinations and is freely available to download from our public website (www.ocr.org.uk) after the live examination series.

If OCR has unwittingly failed to correctly acknowledge or clear any third-party content in this assessment material, OCR will be happy to correct its mistake at the earliest possible opportunity.

For queries or further information please contact The OCR Copyright Team, The Triangle Building, Shaftesbury Road, Cambridge CB2 8EA.

OCR is part of Cambridge University Press & Assessment, which is itself a department of the University of Cambridge.